MATHS WORKSHEET 2: Count the Objects and Add

CBSE Class 1 | Putting Together

Name: _____ Class: 1 ____ Date: _____

Count the pictures in each group. Put them together and write the total in the box.

1.		+		=	
2.		+		=	
3.		+		=	
4.		+		=	
5.		+		=	
6.		+		=	
7.		+		=	
8.		+		=	
9.		+		=	
10.		+		=	

ANSWER KEY: Worksheet 2

Check your answers and correct your mistakes

Name: _____ Class: 1 ____ Date: _____

No.	Question	Answer
1.	4 apples + 3 pears	4 + 3 = **7**
2.	5 pencils + 2 pencils	5 + 2 = **7**
3.	3 balloons + 6 balloons	3 + 6 = **9**
4.	4 flowers + 4 stars	4 + 4 = **8**
5.	7 balls + 3 balls	7 + 3 = **10**
6.	6 apples + 6 pears	6 + 6 = **12**
7.	9 pencils + 5 pencils	9 + 5 = **14**
8.	8 balloons + 7 balloons	8 + 7 = **15**
9.	10 stars + 6 flowers	10 + 6 = **16**
10.	11 fish + 8 fish	11 + 8 = **19**

Great counting! Keep practising every day!