Name:

Written Time

Draw a line to match each time to each written time.

9:00	Four O'clock
11:00	Six O'clock
4:00	Twelve O'clock
10:00	Nine O'clock
7:00	One O'clock
6:00	Seven O'clock
12:00	Eight O'clock
5:00	Eleven O'clock
1:00	Five O'clock
8:00	Ten O'clock

Name_____

TELLING TIME



Write the time below each clock.









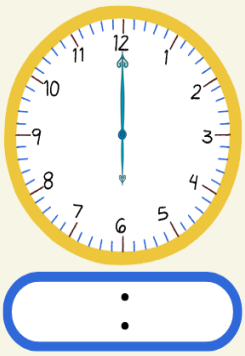







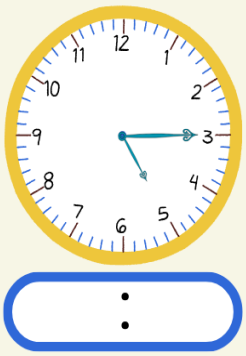

WHAT TIME IS IT?

Telling time.

Fill in the correct time for each clock.

1.



It's two forty-five

2.



3.



4.



5.



6.



Now, draw the hands on the clock to show the time.



It's six thirty



It's five o'clock



It's nine twenty-five

Name: _____ Date: _____

Telling the Time

o'clock

Write the times under each clock.



_____



_____



_____



_____



_____



_____



_____



_____



_____

Name: _____ Date: _____

Telling the Time

o'clock

Draw the times on each clock to match the times.

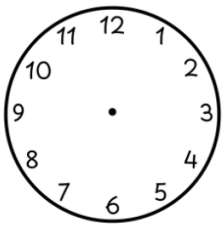

3 o'clock

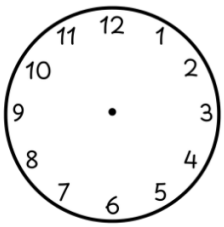

7 o'clock

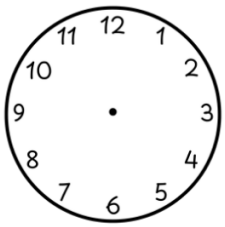

11 o'clock

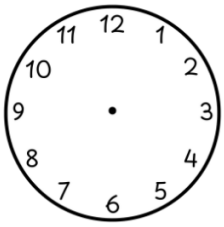

8 o'clock

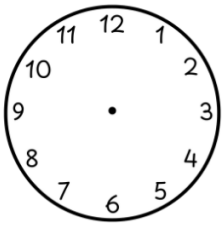

1 o'clock

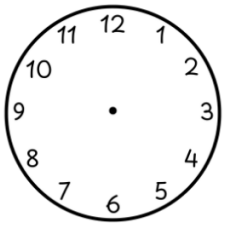

4 o'clock

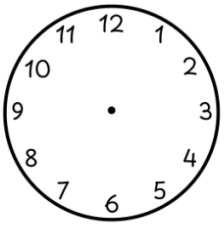

10 o'clock

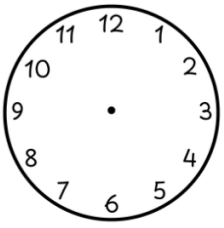

9 o'clock

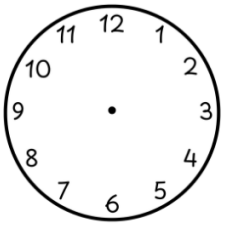

2 o'clock

Name: _____ Date: _____

Telling the Time

Half past

Write the times under each clock.



_____



_____



_____



_____



_____



_____



_____



_____



_____

Name: _____ Date: _____

Telling the Time

Half past

Draw the times on each clock to match the times.

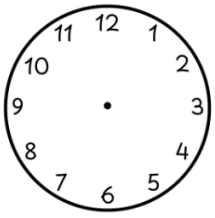

Half past 1

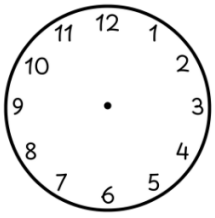

Half past 7

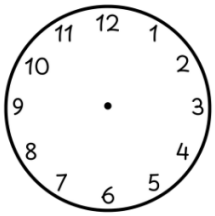

Half past 10

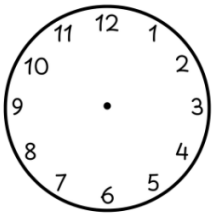

Half past 8

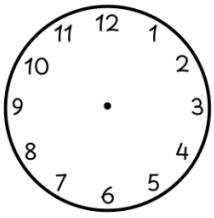

Half past 3

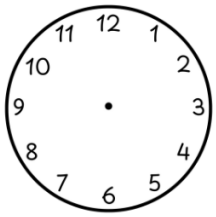

Half past 2

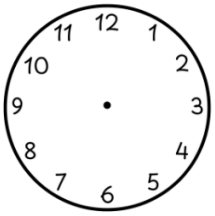

Half past 9

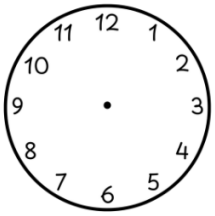

Half past 11

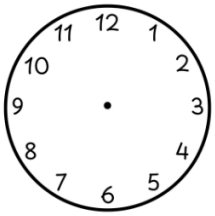

Half past 4

Name: _____ Class: _____

WHAT TIME IS IT?





What time is it?

It is nine o'clock



What time is it?

It is _____



What time is it?

It is _____



What time is it?

It is _____



What time is it?

It is _____



What time is it?

It is _____



What time is it?

It is _____



What time is it?

It is _____



What time is it?

It is _____



What time is it?

It is _____

Name: _____ Class: _____

TELLING TIME

Draw the long and short hands.



I wake up at 6:00.



I eat breakfast at 6:30.



I go to school at 7:00.



Our recess is at 8:45.



Our lunch is at 12:00.



I go home at 3:15.